Maths answers week 5

Shobuj

	Question							
Day 1	1. 40cm	2. 44cm	3. 17cm	4. 24cm	5. 42cm	6. 46cm	7. 64cm	
Day 2	1. 5cm 20cm	2. 8cm 32cm	3. 4cm 14cm	4. 2cm 8cm				
Day 3	5. 9cm 36cm	6. 7cm 28cm	7. 1cm 1cm	8. 3cm 12cm	9. 6cm 24cm			
Day 4	1. 6 cm^2	2. 10 cm^2	3. 9 cm^2	4. 12 cm^2	5. 15 cm^2	6. 3 cm^2	7. 13 cm^2	8. 8 cm^2
Day 5	1. 18 cm^2	2. 14 cm^2	3. 9 cm^2	4. 16 cm^2	5. 16 cm^2	6. 21 cm^2	7. 63 cm^2	8. 8 cm^2
	9. 5 cm^2	10. 28 cm^2						

Caagar

Day 1:

1. 51cm	5. 122cm
2. 70cm	6. 180cm
3. 49cm	7. 59cm
4. 72cm	

Day 2

1. 8.5 cm 34cm	5. 9.5cm 38cm
2. 1cm 1cm	6. 2cm 8cm
3. 3cm 12cm	7. 4.5cm 18cm
4. 5.5cm 22cm	8. 7.5cm 30cm

Day 3

1. 51cm	5. 122cm
2. 71cm	6. 180cm
3. 49cm	7. 192cm
4. 68cm	8. 8cm

Day 4

1. 3 cm^2	7. 16 cm^2
2. 10 cm^2	8 . 12 cm^2
3. 6 cm^2	9. 5 cm^2
4. 4 cm^2	10. 9 cm^2
5. 11 cm^2	11. 12 cm^2
6. 6 cm^2	

Day 5

1. 45 cm^2	6. 60 cm^2
2. 90 cm^2	7. 238 cm^2
3. 42 cm^2	8. 180 cm^2
4. 68 cm^2	9. 126 cm^2
5. 200 cm^2	10. 104 cm^2

Akhdaar

Day 1

1. 8cm	6. 16cm
2. 24cm	7. 1cm
3. 34cm	8. 12cm
4. 1cm	9. 32cm
5. 30cm	10. 22cm

Day 2

1. 28cm	6. 20cm
2. 21cm	7. 14cm
3. 34cm	8. 25cm
4. 21cm	9. 23cm
5. 33cm	10. 20cm

Day 3

11. 164km	12. 286km
13. 274km	14. 256km

Day 4

1. 216 cm^2	6. 2016 cm^2
2. 1365 cm^2	7. 948 cm^2
3. 2130 cm^2	8. 342 cm^2
4. 330 cm^2	9. 289 cm^2
5. 1134 cm^2	10. 61 cm^2

Day 5

1. 6 cm^2	6. 8.25 cm^2
2. 15.75 cm^2	7. 13.75 cm^2
3. 9 cm^2	8. 12cm cm^2
4. 24.75 cm^2	9. 8.75 cm^2
5. 14 cm^2	

How much money is in my jar?

£5.04

£7.72

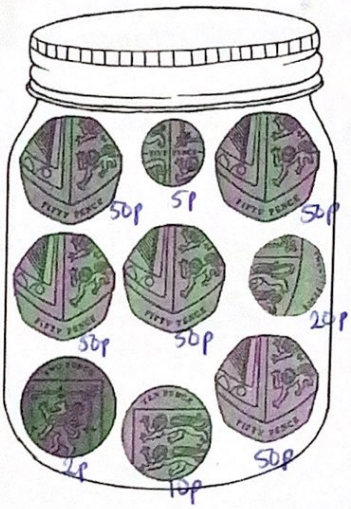

£2.87



£6.55

£9.99

£8.73

Day 1

Make the following totals in the money jars by cutting out the coins on the next page.



£4.85

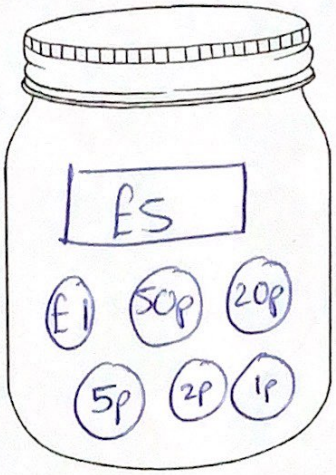

£6.78



£8.28



£7.40



£9.06



£5.94

Day 8

Counting Mixed Coins

Count the coins and write your answers in pence or pounds and pence.

1. 50p 20p

How much? 70pence

2. 10p £1

How much? 1 pound and 10 pence.

3. £2 £1

How much? 3 pounds

4. 10p 5p 50p

How much? 65 pence

5. £1 20p 1p

How much? 1 pound and 21 pence

6. 2p 10p 1p

How much? 13 pence

7. £1 10p 2p 5p

How much? 1 pound and 17 pence

8. 10p £2 50p 1p

How much? 2 pound and 61 pence.

9. 10p 5p 2p 20p

How much? 37 pence

10. 50p £1 10p 5p 1p

How much? £1 pound and 66 pence.

twinkl.co.uk

Day 9

Counting Mixed Coins

Challenge: Count the coins and write your answers in pence and then in pounds and pence.

11.

How much in pence? 102 pence

How much in pounds and pence?

1 pound and 2 pence.

12.

How much in pence? 210 pence

How much in pounds and pence?

2 pound and 10 pence.

13.

How much in pence? _____

How much in pounds and pence?

£4

14.

How much in pence? 388 pence

How much in pounds and pence?

£3 pounds and 88 pence

twinkl.co.uk

Day 10

Addition with Money

Find the total cost of the items below. You will find the price of each item from the Grocery Store Price List. Use the space to show your working.

Grocery Store Price List:

apple 53p	pack of tomatoes 78p	pepper 60p
banana 41p	milk £2.81	rice £3.65
carrot 59p	cheese £2.92	tuna £5.65
pineapple £1.52	chocolate £3.10	bacon £1.82
pack of strawberries 84p	eggs £1.24	
box of peaches £1.32	spaghetti £2.38	

1.

53p 41p

$$\begin{array}{r} 53 \\ +\ 41 \\ \hline 94 \end{array}$$

Total price = 94p

2.

41p 59p + 59p

$$\begin{array}{r} 41 \\ 59 \\ +\ 59 \\ \hline 1\cdot59 \end{array}$$

Total price = £1·59

3.



£1·52 53p 84p

$$\begin{array}{r} 1\cdot52 \\ 53 \\ +\ 84 \\ \hline 2\cdot89 \end{array}$$

Total price = £2·89

4.



£1·52 £1·32

$$\begin{array}{r} 1\cdot52 \\ +\ 1\cdot32 \\ \hline 2\cdot84 \end{array}$$

Total price = £2·84

5.

78p 59p + 59p

$$\begin{array}{r} 78 \\ 59 \\ +\ 59 \\ \hline 1\cdot96 \end{array}$$

Total price = £1·96

6.



53p 78p

$$\begin{array}{r} 53 \\ +\ 78 \\ \hline 1\cdot31 \end{array}$$

Total price = £1·31

Addition with Money

Find the total cost of the items below. You will find the price of each item from the Grocery Store Price List. Use the space to show your working.

7.

£2·81 £2·92

2·81
2·92 +
1
5·73

Total price = £5·73

8.

£3·10 £1·24

3·10
1·24 +
4·34

Total price = £4·34

9. 

£3·10 £2·81 £1·24

3·10
2·81 +
1·24
1
7·15

Total price = £7·15

10. 

£2·38 £1·24

2·38
1·24 +
3·62

Total price = £3·62

11.

£2·38 78p 60p

2·38
78 +
1 1 60
3·76

Total price = £3·76

12.

£2·92 78p £3·65

2·92
78 +
2 3·165
7·35

Total price = £7·35

13.

£2·38 78p 5·65

2·38
78 +
1 5 65
8·81

Total price = £8·81

14.

£1·82 78p 60p £1·24

1·82
78
60
2 1·24
4·44

Total price = £4·44

	★★★
	1. 94p 2. £1.59 3. £2.89 4. £2.84 5. £1.96 6. £1.31 7. £5.73 8. £4.34 9. £7.15 10. £3.62 11. £3.76 12. £7.35 13. £8.81 14. £4.44 Challenge: Recipe 1: £7.75 Recipe 2: £16.77 Recipe 3: £11.71

How much money is in my jar?

£5.04

£7.72

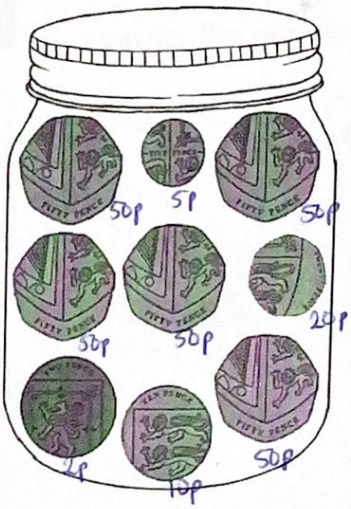

£2.87



£6.55

£9.99

£8.73

Day 1

Make the following totals in the money jars by cutting out the coins on the next page.



£4.85

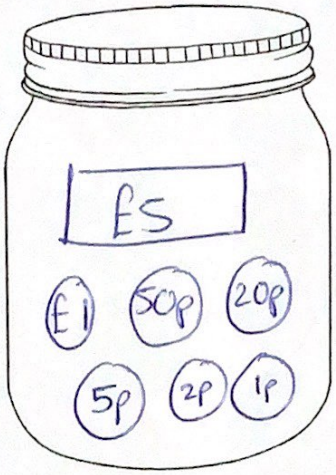

£6.78



£8.28



£7.40



£9.06



£5.94

Day 8

Counting Mixed Coins

Count the coins and write your answers in pence or pounds and pence.

1. 50p 20p

How much? 70pence

2. 10p £1

How much? 1 pound and 10 pence.

3. £2 £1

How much? 3 pounds

4. 10p 5p 50p

How much? 65 pence

5. £1 20p 1p

How much? 1 pound and 21 pence

6. 2p 10p 1p

How much? 13 pence

7. £1 10p 2p 5p

How much? 1 pound and 17 pence

8. 10p £2 50p 1p

How much? 2 pound and 61 pence.

9. 10p 5p 2p 20p

How much? 37 pence

10. 50p £1 10p 5p 1p

How much? £1 pound and 66 pence.

twinkl.co.uk

Day 9

Counting Mixed Coins

Challenge: Count the coins and write your answers in pence and then in pounds and pence.

11.

How much in pence? 102 pence

How much in pounds and pence?

1 pound and 2 pence.

12.

How much in pence? 210 pence

How much in pounds and pence?

2 pound and 10 pence.

13.

How much in pence? _____

How much in pounds and pence?

£4

14.

How much in pence? 388 pence

How much in pounds and pence?

£3 pounds and 88 pence

twinkl.co.uk

★★

1. 90p
2. £1.40
3. £2.80
4. £3.50
5. £1.90
6. £1.40
7. £5.70
8. £5.60
9. £8.40
10. £4.80
11. £3.80
12. £7.40

Day 6

How much money is in my jar?



75p

£1

84p



71p

~~3~~ 38p

83p

Day 1

Make the following totals in the money jars by cutting out the coins on the next page.



36p

91p



59p



43p



62p



88p

★

1. 90p
2. £1.40
3. £2.80
4. £3.50
5. £1.90
6. £1.40
7. £4.55
8. £5.50
9. £7.50
10. £2.60